Completing and Matching Volume Equations

Name:

Match each problem with the equation that could represent it. Answer with the missing term and letter.

Ex)

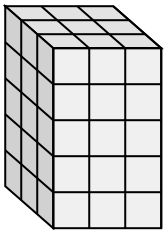

1)

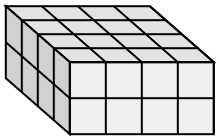

2)

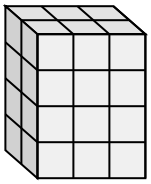

3)

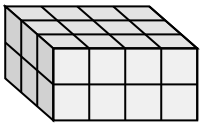

4)

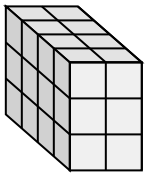

5)

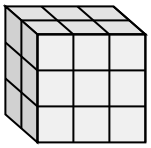

6)

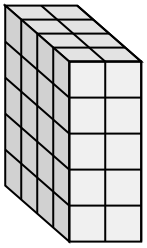

7)

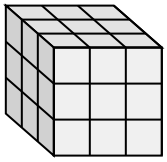

8)

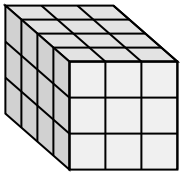

9)

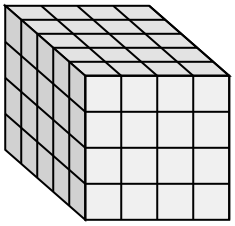

10)

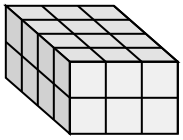

11)

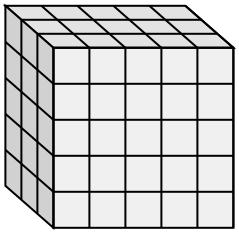

A) 3 × 5 × 5 = ___

B) 3 × 4 × 2 = ___

C) ___ × 3 × 3 = 27

D) 4 × 4 × 2 = ___

E) 5 × 4 × ___ = 80

F) 2 × ___ × 4 = 24

G) 2 × ___ × 3 = 18

H) 4 × 2 × 5 = ___

I) ___ × 3 × 2 = 24

J) 4 × 3 × 3 = ___

K) ___ × 2 × 3 = 24

L) 3 × 3 × ___ = 45

Answers

Ex. L , 5

1. _____
2. _____
3. _____
4. _____
5. _____
6. _____
7. _____
8. _____
9. _____
10. _____
11. _____

Completing and Matching Volume Equations Name: **Answer Key**

Match each problem with the equation that could represent it. Answer with the missing term and letter.

Ex) 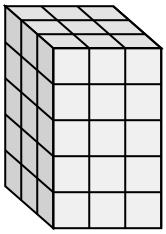

1) 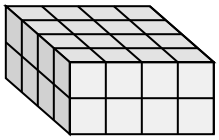

2) 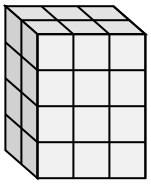

3) 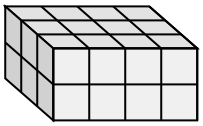

4) 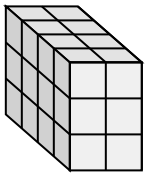

5) 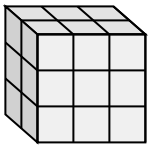

6) 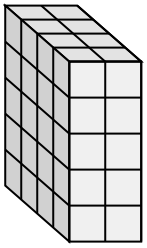

7) 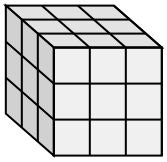

8) 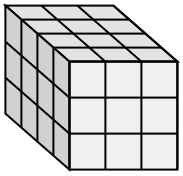

9) 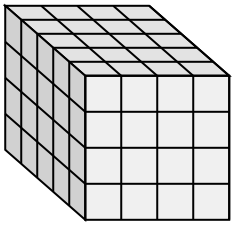

10) 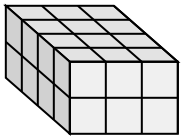

11) 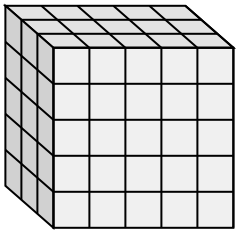

A) 3 × 5 × 5 = ___

B) 3 × 4 × 2 = ___

C) ___ × 3 × 3 = 27

D) 4 × 4 × 2 = ___

E) 5 × 4 × ___ = 80

F) 2 × ___ × 4 = 24

G) 2 × ___ × 3 = 18

H) 4 × 2 × 5 = ___

I) ___ × 3 × 2 = 24

J) 4 × 3 × 3 = ___

K) ___ × 2 × 3 = 24

L) 3 × 3 × ___ = 45

Answers

Ex.	L , 5
1.	D , 32
2.	F , 3
3.	B , 24
4.	K , 4
5.	G , 3
6.	H , 40
7.	C , 3
8.	J , 36
9.	E , 4
10.	I , 4
11.	A , 75